Winkel messen und zeichnen



① Wie groß ist der Winkel? Miss und notiere die Winkelgröße.

a)

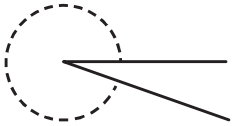

b)

c)

d)

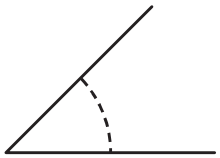

e)

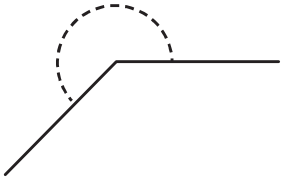

② Zeichne folgende Winkel.

a) 90° b) 270° c) 105° d) 308° e) 66° f) 124°

a) b) c)

d) e) f)

© Persen Verlag, Buxtehude